The Same as Half

What do you notice?

Colour $\frac{1}{2}$ of this shape.



Colour $\frac{2}{4}$ of this shape.



Colour $\frac{1}{2}$ of this shape.

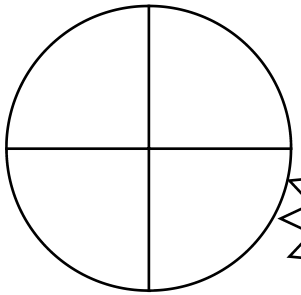

Colour $\frac{2}{4}$ of this

What do you notice?

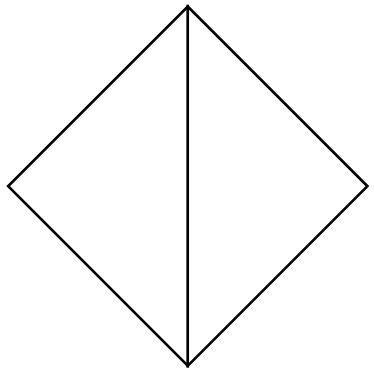

Colour $\frac{1}{2}$ of this shape.

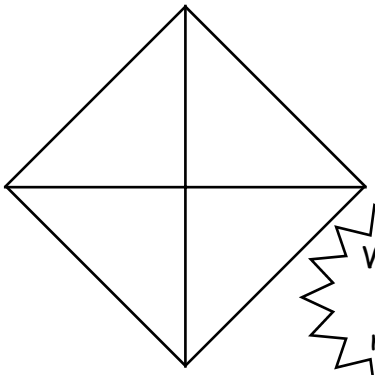

What do you notice?

Colour $\frac{2}{4}$ of this shape.

Resource Shop

Equivalent to a Half





What do you notice?

Colour half of the shape. Colour 2 quarters of this



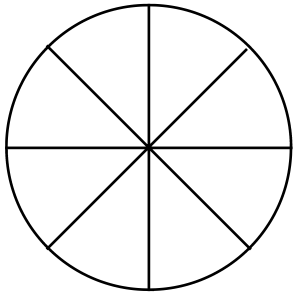

What do you notice?

Colour half of the shape. Colour $\frac{4}{8}$ of this shape.

What do you notice?

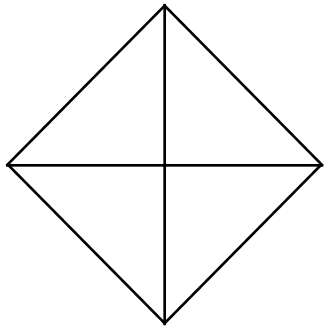

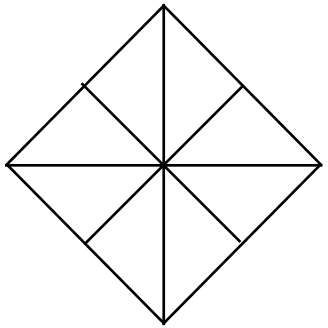

Colour half of the shape. Colour $\frac{4}{8}$ of the shape.

Resource Shop